All rights reserved. No part of this publication may be reproduced, distributed, or transmitted in any form or by any means, electronic, mechanical, photocopying, recording or otherwise, or stored in any retrieval system of any nature without the permission of cracku.in, application for which shall be made to support@cracku.in

Downloaded from cracku.in

SSC CHSL 12th August 2021 Shift-3

English Language

1. **Select the most appropriate ANTONYM of the given word.**
   Traditional

A Earthly

B Customary

C Modern

D Conventional

Answer: C

2. **Select the option which means the same as the group of words given.**
   A hunting weapon which comes back, used by Australian Aborigines

A harpoon

B cutlass

C slingshot

D boomerang

Answer: D

3. **The following sentence has been split into four segments. Identify the segment that contains a grammatical error.**
   It would be / more better if / she sang / with an orchestra.

A more better if

B she sang

C with an orchestra

D It would be

Answer: A

4. **Select the option that expresses the given sentence in reported speech.**
   "Our teacher returned from Mumbai last month", she said.

A She said that her teacher had returned from Mumbai the earlier month.

B Her teacher returned from Mumbai last month, she said.

C She said that their teacher had returned from Mumbai the previous month.

D She said that her teacher had returned from Mumbai the previous month.

Answer: C

SSC CHSL Free Mock Test

Downloaded from cracku.in

5. **Select the correct passive form of the given sentence.**
In the evening we water the plants.

A The plants will be watered in the evening.

B The plants are watered in the evening.

C The plants have been watered in the evening.

D The plants were watered in the evening.

Answer: B

6. **Select the option that can be used as a one-word substitute for the given group of words.**
Causing a strong dislike

A Redundant

B Repulsive

C Hateful

D Revealing

Answer: B

7. **Select the most appropriate option to substitute the underlined segment in the given sentence. If there is no need to substitute it, select 'No substitution'.**
Mr. Sharma is <u>kind as</u> his father.

A as kind as

B No substitution

C the kindest as

D kinder as

Answer: A

SSC CHSL Prevoius Papers (DOWNLOAD PDF)

8. **Select the most appropriate meaning of the given idiom.**
Not one's cup of tea

A Not absolutely true

B Not according to one's interest

C Beyond one's comprehension

D Of no concern for someone

Answer: B

9. **Given below are four jumbled sentences. Out of the given options, pick the one that gives their correct order.**
A. The man who had caught me was a dreadful sight.
B. Suddenly I was picked up, whirled through the air, and made to sit on a tombstone.
C. He was about forty years old, hard-faced and fierce.
D. I was only a child, and small for my age.

Downloaded from cracku.in

A CBAD

B BACD

C DBAC

D DCBA

Answer: C

10. **Sentences of a paragraph are given below in jumbled order. Arrange the sentences in the right order to form a meaningful and coherent paragraph.**
A. The whole area has been designed like a garden from Alice in Wonderland.
B. It's about having fun and learning, too; all the activities help to explain the modern world of technology to the young visitors.
C. But 'The World of Children' isn't just about playing games and having joy rides.
D. There are several different attractions in this vast area and there is a lot to see and do.

A DACB

B BCDA

C CBDA

D ADBC

Answer: A

SSC CGL Previous Papers (DOWNLOAD PDF)

11. **Select the INCORRECTLY spelt word.**

A rogue

B rocket

C rockiry

D roaster

Answer: C

12. **Select the most appropriate option to fill in the blank.**
Scientists all over the world are engaged in _____ how to find a vaccine for COVID-19.

A researching

B scrutinizing

C investigating

D inspecting

Answer: C

13. **Select the most appropriate synonym of the given word.**
REPULSIVE

A respectable

Downloaded from cracku.in

B disgusting

C attractive

D agreeable

Answer: B

SSC CGL Free Mock Test (Latest Pattern)

14. **Select the most appropriate option to substitute the underlined segment in the given sentence. If there is no need to substitute it, select 'No substitution required'.**
He won't come to the party unless you <u>will invite</u> him personally.

A would invite

B invite

C No substitution required

D invited

Answer: B

15. **Select the most appropriate meaning of the idiomatic expression given.**
To cross one's mind

A To forget something

B To put a thought away from one's mind

C To move from one idea to another

D To think of something

Answer: D

16. **Select the most appropriate word to fill in the blank.**
The marking of answer papers is _____ out by the course teacher.

A done

B carried

C checked

D crossed

Answer: B

SSC CHSL Important Questions and Answers (Download PDF)

17. **Select the most appropriate ANTONYM of the given word.**
BUOYANT

A enthusiastic

B lively

Downloaded from cracku.in

C weighted

D bouncy

Answer: C

18. **Select the INCORRECTLY spelt word.**

A Terrible

B Uprooted

C Haunted

D Tendansy

Answer: D

19. **In the given sentence, identify the segment which contains the grammatical error.**
Cyclone Amphan roared into West Bengal on Wednesday leave behind a trail of devastation across a large area of the State.

A leave behind

B a trail of devastation

C roared into West Bengal

D across a large area

Answer: A

SSC CHSL Study Material

20. **Select the most appropriate synonym of the given word.**
Ban

A Ascertain

B Prohibit

C Abandon

D Band

Answer: B

Instructions [21 - 25]

In the following passage some words have been deleted. Fill in the blanks with the help of the alternatives given. Select the most appropriate option for each blank.

Comprehension:
Every Monday, on his way back from work, Bepin Chaudhury would drop in at KaliCharan's in New Market (1)_____ books. Crime stories, ghost stories, and thrillers. (2)_____ had to buy at
least five at a time to last him (3)_____ the week. He lived alone, was not a good mixer, had few (4)_____ , and didn't like spending time in idle chat. Today, at KaliCharan's, Bepin Babu
had a (5)_____ that somebody was observing him from close quarters.

21. **Select the most appropriate option for blank no. 1.**

A buying

Downloaded from cracku.in

B bought

C to buy

D buy

Answer: C

22. **Select the most appropriate option for blank no. 2.**

A They

B He

C Him

D She

Answer: B

SSC CHSL Free App

23. **Select the most appropriate option for blank no. 3.**

A within

B through

C across

D by

Answer: B

24. **Select the most appropriate option for blank no. 4.**

A friends

B students

C servants

D followers

Answer: A

25. **Select the most appropriate option for blank no. 5.**

A intuition

B connotation

C feeling

D perception

Answer: C

Daily Free SSC Practice Set

Downloaded from cracku.in

26. **Select the set of classes the relationship among which is best illustrated by the following Venn diagram.**

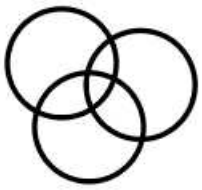

A Owls, Mammals, Reptiles

B Stationery, Pens, Pencils

C Doctors, Fathers, Brothers

D Mothers, Engineers, Women

Answer: C

Free SSC Study Material (18,000 Solved Questions)

27. **Select the option in which the numbers are related in the same way as are the numbers of the following set.**
(2, 3, 62)

A (8, 5, 225)

B (7, 4, 226)

C (5, 9, 288)

D (6, 4, 122)

Answer: B

28. **A cube is made by folding the given sheet. In the cube so formed, what would be the letter on the opposite side of 'K'?**

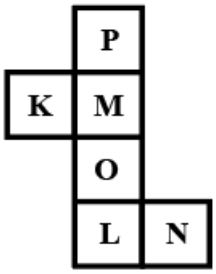

A L

B P

C N

D O

Answer: C

29. **Select the option in which the numbers in the set share the same relationship as that shared by the numbers of the given set.**
(14, 18, 42)

Downloaded from cracku.in

A (16, 21, 56)

B (22, 18, 74)

C (20, 15, 100)

D (40, 23, 94)

Answer: A

1500+ Very Important Free SSC Solved Questions

30. **Select the correct combination of mathematical signs to sequentially replace the * signs to balance the following equation.**
40 * 15 * 3 * 72 * 9 = 77

A $\times, \div, +, -, =$

B $+, \div, -, \times, =$

C $+, \times, -, \div, =$

D $+, \times, \div, -, =$

Answer: C

31. **Three of the following four words are alike in a certain way and one is different. Select the odd one.**

A Heart

B Lungs

C Nose

D Liver

Answer: C

32. **Select the correct option that indicates the arrangement of the given words in the order in which they appear in an English dictionary.**
1. Industry
2. Indent
3. Indoor
4. Indolent
5. Index

A 2, 1, 3, 5, 4

B 2, 5, 4, 3, 1

C 2, 4, 5, 3, 1

D 1, 2, 3, 5, 4

Answer: B

SSC Exam Update Videos & Free Study Material (YouTube Channel)

Downloaded from cracku.in

33. **Select the combination of letters that when sequentially placed in the blanks of the given series will complete the series.**
c k _ g k c _ t _ k _ k t g _ c k _ g k

A t, k, g, c, k, t

B t, k, g, c, c, t

C t, g, k, c, k, t

D t, k, c, g, k, t

Answer: A

34. **Select the correct mirror image of the given figure when a mirror is placed on the right side of the figure.**

A

B

C

D

Answer: D

35. **Select the option that is related to the fourth number in the same way as the first number is related to the second number and the fifth number is related to the sixth number.**
127 : 11 :: ? : 16 :: 367 : 19

A 280

B 216

C 262

Downloaded from cracku.in

D 248

Answer: C

Latest Job Updates on Telegram - Join here

36. **Select the figure from among the given options that can replace the question mark (?) in the following series.**

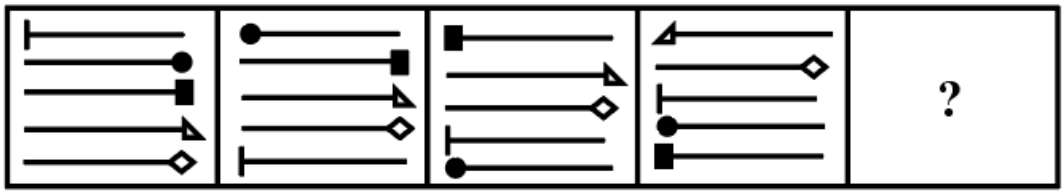

A 

B 

C 

D 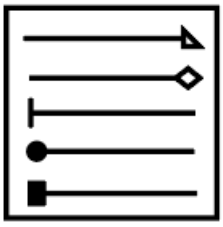

Answer: A

37. **Select the number that can replace the question mark (?) in the following series.**
25, 26, 53, 160, 641, ?

A 3403

B 3202

C 2908

D 3206

Answer: D

Downloaded from cracku.in

38. **Four letter-clusters have been given, out of which three are alike in some manner and one is different. Select the letter-cluster that is different.**

A HNTZ

B AGMS

C IPVA

D VBHN

Answer: C

Join SSC Daily Quiz Telegram Group

39. **Select the option that is related to the third letter-cluster in the same way as the second letter-cluster is related to the first letter-cluster.**
AZW : GFC : : LSM : ?

A RXY

B QOS

C RYS

D DMT

Answer: C

40. **How many triangles are there in the given figure?**

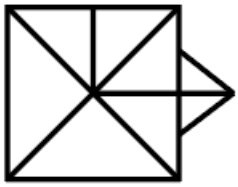

A 15

B 17

C 16

D 14

Answer: A

41. **A piece of paper is folded and cut as shown below in the question figures. Select from the option figures, how it will appear when unfolded.**

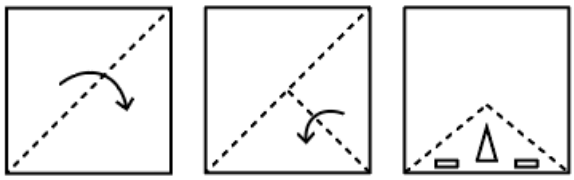

Downloaded from cracku.in

A 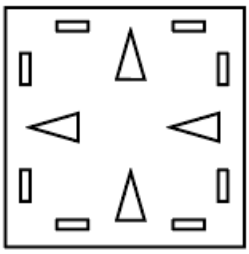

B 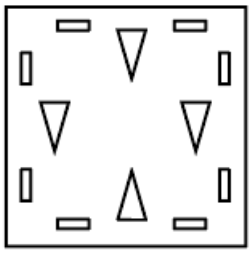

C 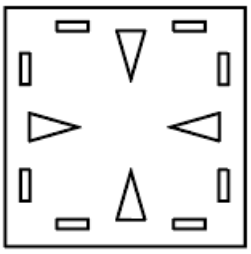

D 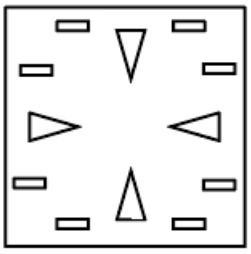

Answer: C

42. **In a certain code language, 'FROZEN' is coded as '504' and 'TONSILS' is coded as '756'. How will 'MARINE' be coded in that language?**

A 360

B 652

C 520

D 456

Answer: A

43. **In a code language, TOUCH is written as UTOHC. How will PLANT be written in that language?**

A QMBOU

B TPANM

C ALRPT

D TPNLA

Answer: D

Downloaded from cracku.in

44. **Two statements are given, followed by three conclusions numbered I, II and III. Assuming the statements to be true, even if they seem to be at variance with commonly known facts,**
decide which of the conclusions logically follow(s) from the statements.
Statements:
No field is a house.
All fields are parks.
Conclusions:
I. No house is a field.
II. Some parks are fields.
III. Some houses are fields.

A Only conclusion II follows

B All the conclusions follow

C Only conclusions II and III follow

D Only conclusions I and II follow

Answer: D

SSC CHSL Free Mock Test

45. **Four number-pairs have been given, out of which three are alike in some manner and one is different. Select the number-pair that is different.**

A 7 : 63

B 5 : 35

C 13 : 195

D 19 : 324

Answer: D

46. **In a class of 68 students, 34 students participated only in Debate and 8 students participated in both Quiz and Debate. If every student of the class has participated in at**
least one of these two competitions, how many students participated in Quiz?

A 26

B 34

C 30

D 22

Answer: B

47. **If 'A & B' means 'A is the father of B' and 'A @ B' means 'A is the sister of B', then which of the following expressions means 'H is the father of M'?**

A K & H @ P @ M

B M & K @ P @ H

C H & K @ P @ M

D H @ K @ P & M

Downloaded from cracku.in

Answer: C

SSC CHSL Prevoius Papers (DOWNLOAD PDF)

48. **Select the option in which the words share the same relationship as that shared by the given pair of words.**
Astronomy : Stars

A Seismology : Theatre

B Psychology : Cells

C Numismatics : Coins

D Philology : Texture

Answer: C

49. **'East' is related to 'Direction' in the same way as 'Summer' is related to '_____'.**

A Season

B Room Cooler

C Heat

D Temperature

Answer: A

50. **Select the option figure which contains figure X embedded in it as its part (rotation is NOT allowed).**

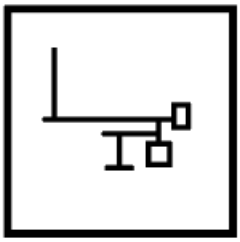

Figure X

A

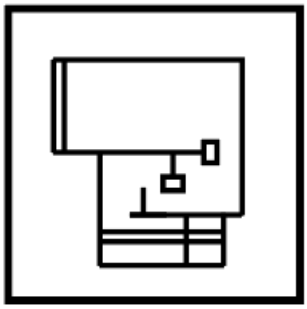

B

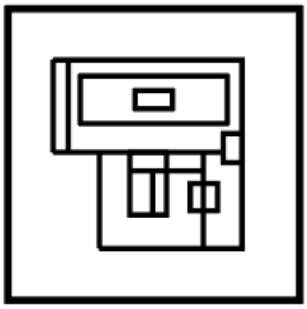

Downloaded from cracku.in

C 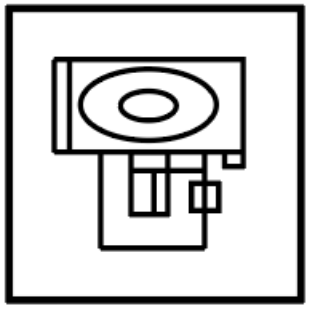

D

Answer: B

SSC CGL Previous Papers (DOWNLOAD PDF)

Quantitative Aptitude

51. **24% of Reena's salary is equal to 38% of Sunita's salary. Veena's salary is two-third of the total salary of Reena and Sunita. If Veena's salary is ₹62,000, then Sunita's salary is:**

A ₹35,000

B ₹32,000

C ₹38,000

D ₹36,000

Answer: D

SSC CGL Free Mock Test (Latest Pattern)

Downloaded from cracku.in

52. **Study the given bar graphs and answer the question that follows.**
The bar graphs represent the amount invested in raw materials (in ₹ crore) and the sale of the products, by a textile company in the years 2007— 2012. The X-axis represents the years. The Y-axis represents the amount invested in raw materials (in ₹ crore) in figure 1 and sale of products in figure 2, respectively.

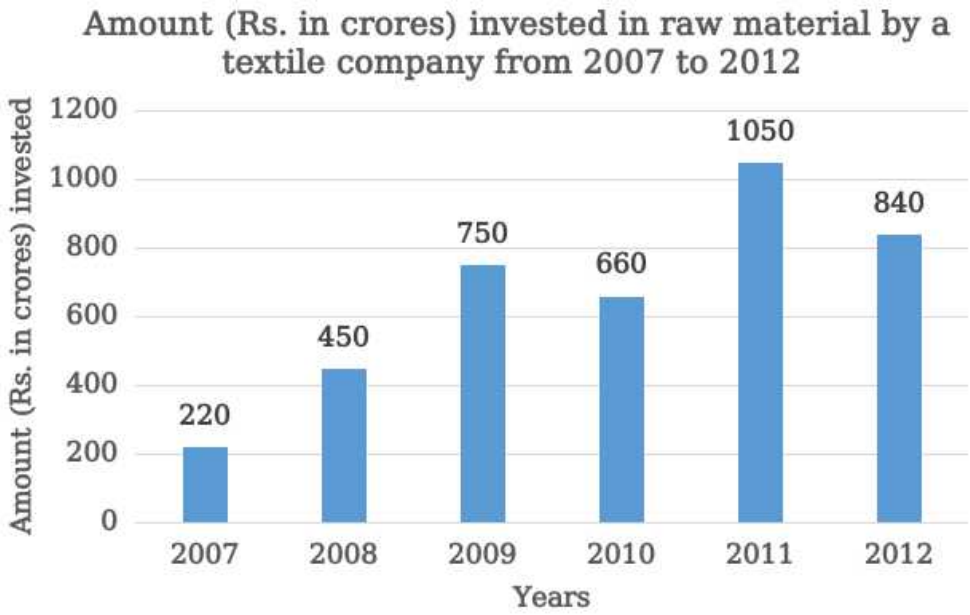

Figure 1

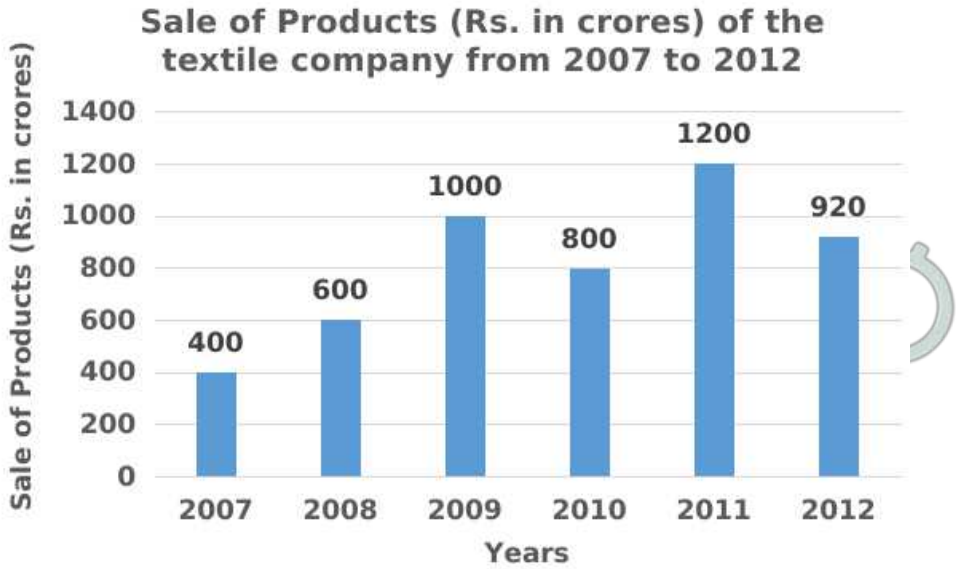

Figure 2

In which year was there a maximum percentage increase in the sales of products as compared to the previous year?

A 2008

B 2010

C 2009

D 2011

Answer: C

53. **A man invests an amount of ₹1,05,750 at simple interest in the name of his son, daughter and his wife in such a way that they get the same interest after 3, 4 and 5 years, respectively.If the rate of interest is 5% per annum, then the amount invested for the wife is:**

A ₹27,000

Downloaded from cracku.in

B ₹28,000

C ₹25,000

D ₹30,000

Answer: A

54. **If a triangle ABC is right-angled at A, then what is the value of** $\sin\frac{B+C}{2}\cos\frac{B+C}{2}$**?**

A $\frac{\sqrt{3}}{4}$

B $\sqrt{2}$

C $\frac{1}{4}$

D $\frac{1}{2}$

Answer: D

SSC CHSL Important Questions and Answers (Download PDF)

55. **The sum of all the three sides of an equilateral triangle is** $15\sqrt{3}$ **cm. The height of the triangle is:**

A 7 cm

B 8 cm

C 7.5 cm

D 9 cm

Answer: C

56. **Anu can complete a piece of work in 22 days. Shama is 60% more efficient than Anu. How many days does Shama alone take to complete the same piece of work?**

A $36\frac{2}{3}$

B $35\frac{1}{3}$

C $13\frac{1}{5}$

D $13\frac{3}{4}$

Answer: D

Downloaded from cracku.in

57. **Study the given bar graph and answer the question that follows.**
A tea plantation company produces three varieties of tea—black tea, green tea and herbal tea. The production of three varieties (in million tonnes) over a period of six years from 2014 to 2019, has been shown in the bar graph here. The X-axis represents the years and the Y-axis displays the production of the three varieties in million tonnes.

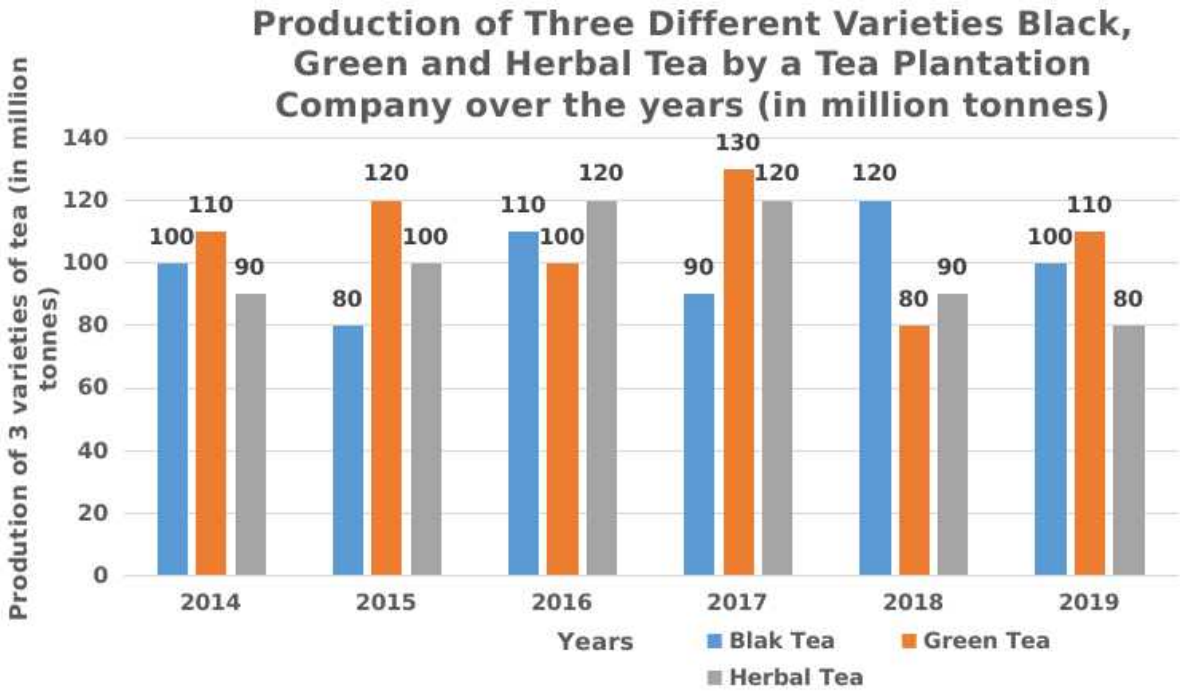

The average production of black tea in 2014, 2015 and 2018 is how much more or less(in million tonnes) than the average production of green tea in 2016, 2017 and 2019?

A More, 12.33

B Less, 12.33

C Less, 13.33

D More, 13.33

Answer: C

SSC CHSL Study Material

58. **Two numbers A and are in the ratio 13 : 17. If A is increased by 15%and is increased by 30%, then the new ratio of A to B will be:**

A 21 : 29

B 21 : 31

C 23 : 34

D 23 : 33

Answer: C

59. **In $\triangle ABC, AC = BC$, and the length of the base AB is 10 cm. If CG = 8 cm, where G is the centroid, then what is the length of AC ?**

A 13 cm

B 15 cm

Downloaded from cracku.in

C $\sqrt{91}$ cm

D 12 cm

Answer: A

60. **A,B, C and D are four positive numbers such that A is $\frac{3}{4}$ times of B, B is $\frac{4}{5}$ times of C, and C is $\frac{3}{8}$ times of D. If the average of 4 times of A and 7 times of D is 316, then the average of all the four numbers A, B, C and D is:**

A 36

B 38

C 28

D 34

Answer: B

SSC CHSL Free App

61. **A car takes 50 minutes to cover a certain distance at a speed of 54 km/h. If the speed is increased by 25%, then how long will it take to cover three-fourth of the same distance?**

A 35 minutes

B 40 minutes

C 30 minutes

D 25 minutes

Answer: C

Downloaded from cracku.in

62. **The given pie charts represent the distribution of candidates who enrolled for a bank clerical examination and the candidates (out of those enrolled) who passed the examination, from five different institutes P,Q. R. S and T. Study the pie charts and answer the question that follows.**
(i) Total number of candidates who enrolled for the examination from five institutes = 5500

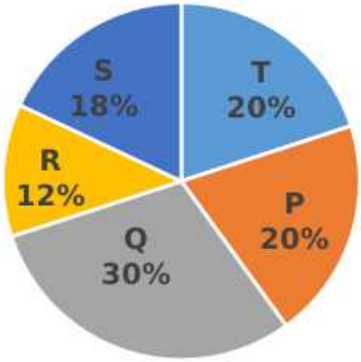

Fig. (i)

(ii) Total number of candidates who passed the examination from five institutes = 3300

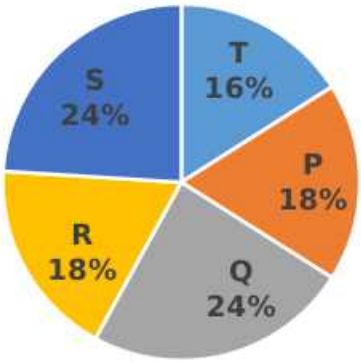

Fig.(ii)

Which institute(s) has/have the highest percentage of candidates passed to the candidates enrolled?

A P

B S

C Q and T

D R

Answer: D

63. **A rectangle with perimeter 50 cm has its sides in the ratio 1 : 4. What is the perimeter of a square whose area is the same as that of the rectangle?**

A 36 cm

B 50 cm

C 40 cm

D 45 cm

Answer: C

Daily Free SSC Practice Set

64. **If** $x^2 + \frac{1}{x^2} = 83, x > 0$**, then the value of** $x^3 - \frac{1}{x^3}$ **is:**

Downloaded from cracku.in

A 756

B 675

C 576

D 746

Answer: A

65. **Two equal circles of radius 8 cm intersect each other such that each passes through the centre of the other. The length of the common chord is:**

A 8 cm

B $4\sqrt{3}$ cm

C $8\sqrt{3}$ cm

D $8\sqrt{2}$ cm

Answer: C

66. **If $\tan A + \sec A = \frac{3}{2}$ and A is an acute angle, then the value of $\frac{10\cot A + 13\cos A}{12\tan A + 5\operatorname{cosec} A}$ is:**

A 5

B 1

C 4

D 2

Answer: D

Free SSC Study Material (18,000 Solved Questions)

67. **Two circles with centres O and P and radii 17 cm and 10 cm. respectively, intersect each other at A and B. The length of the common chord AB is 16 cm. What is the perimeter of the triangle OAP (in cm)?**

A 33

B 25

C 48

D 40

Answer: C

68. **If $x + \frac{1}{x} = \sqrt{13}$, then one of the values of $x^3 - \frac{1}{x^3}$ is:**

A $4\sqrt{11}$

B 32

C $4\sqrt{13}$

Downloaded from cracku.in

D 36

Answer: D

69. **The number of students enrolled in different streams at Senior Secondary level in five schools is shown in the given bar graph.**

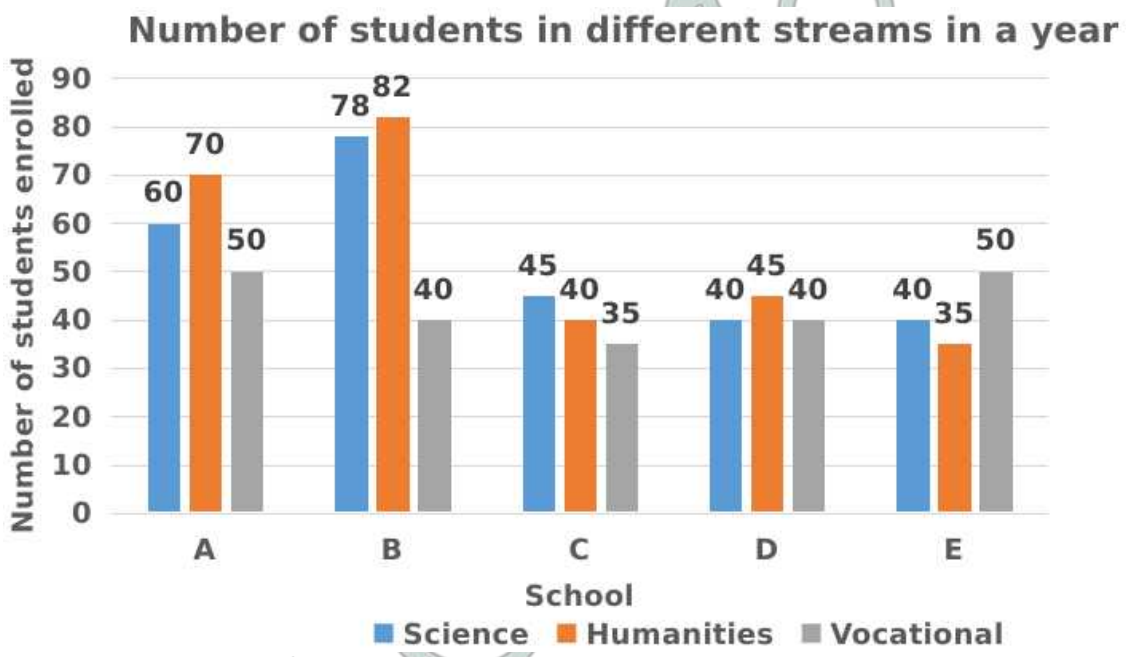

What is the total number of students enrolled in the Science stream in all the schools?

A 267

B 268

C 263

D 257

Answer: C

1500+ Very Important Free SSC Solved Questions

70. **If the nine-digit number '8475639AB' is divisible by 99, then what is the value of A and B?**

A A = 4, B = 6

B A = 5, B = 3

C A = 3, B = 9

D A = 4, B = 8

Answer: D

71. **If** $\sec\theta - \operatorname{cosec}\theta = 0$ **and** θ **is an acute angle, then what is the value of** $sec^2\theta + \operatorname{cosec}^2\theta$ **?**

A 4

B 1

C 2

D 0

Downloaded from cracku.in

Answer: A

72. **What will be the selling price of an article if two successive discounts of 15% and 12% are offered on its marked price of ₹25,500?**

A ₹19,074

B ₹25,041

C ₹21,165

D ₹18,615

Answer: A

SSC Exam Update Videos & Free Study Material (YouTube Channel)

73. **A shopkeeper sold an article for ₹3,750. If he had charged 24%less, even then he would have earned a profit of 14%. What is the original cost of the article?**

A ₹2,850

B ₹2,717

C ₹3,289

D ₹2,500

Answer: D

74. **If** $x^2 + (4 - \sqrt{3})x - 1 = 0$**, then what is the value of** $x^2 + \frac{1}{x^2}$**?**

A $9 - 8\sqrt{3}$

B $21 - 12\sqrt{3}$

C $21 - 8\sqrt{3}$

D $17 - 8\sqrt{3}$

Answer: C

75. **Simplify the following expression.**
$5\frac{1}{3} \div \left[7 - 3 \div \left(1 - \frac{1}{4}\right) \times \frac{2}{3} + 1\right] - 3 \div 1 + 2$

A $\frac{7}{41}$

B 0

C 15

D -4

Answer: B

Latest Job Updates on Telegram - Join here

Downloaded from cracku.in

General Awareness

76. **National Rifle Association of India was founded in:**

A 1956

B 1964

C 1951

D 1948

Answer: C

Join SSC Daily Quiz Telegram Group

77. **Which of the following factors is NOT responsible for soil formation?**

A Topography

B Cattle grazing

C Parent material

D Biotic agents

Answer: B

78. **Who among the following was NOT included in the ICC Hall of Fame in August 2020?**

A Graeme Smith

B Jacques Kallis

C Zaheer Abbas

D Lisa Sthalekar

Answer: A

79. **Which of the following Articles of the Constitution of India is related to the oath or affirmation by the President?**

A Article 57

B Article 60

C Article 66

D Article 54

Answer: B

80. **Rickets and night-blindness are caused by the deficiency of _____ and _____, respectively.**

A Vitamin D, Vitamin A

B Vitamin D, Vitamin C

C Vitamin B1, Vitamin C

Downloaded from cracku.in

D Vitamin E, Vitamin A

Answer: A

81. **Who among the following foreign travellers is NOT correctly matched with their respective country they hail from?**

A Marco Polo - Italy

B Peter Mundy - China

C Ibn Battuta - Morocco

D Al-Biruni - Uzbekistan

Answer: B

82. **With which of the following states is the 'Mand' or 'Maand' style of singing associated?**

A Rajasthan

B Gujarat

C Madhya Pradesh

D Uttar Pradesh

Answer: A

SSC CHSL Free Mock Test

83. **With which country did India hold its 14th Defence Policy Dialogue via video conferencing in August 2020?**

A The US

B Japan

C Singapore

D China

Answer: C

84. **Which of the following statements is NOT correct about alluvial soil?**

A Deltas of Mahanadi, the Godavari and the Krishna are made from alluvial soil.

B Old alluvial is called 'bangar' and new alluvial is called 'khadar'.

C In the Himalayan region we find alluvial soil.

D Northern plains are made of alluvial soil.

Answer: C

85. **As of January 2021, GMR Group was associated with which of the following franchises in the Indian Premier League (IPL) cricket tournament?**

A Delhi Capitals

Downloaded from cracku.in

B Mumbai Indians

C Chennai Super Kings

D Rajasthan Royals

Answer: A

SSC CHSL Prevoius Papers (DOWNLOAD PDF)

86. **According to the fundamental rights provided by the Constitution of India, the state is bound to provide free and compulsory education to all children from the age of:**

A 4 to 15 years

B 6 to 14 years

C 4 to 18 years

D 3 to 18 years

Answer: B

87. **Swollen bluish veins resulting from the valves that do not close properly are called _____.**

A systemic veins

B varicose veins

C deep veins

D superficial veins

Answer: B

88. **Dogri language is mainly spoken in which of the following states/union territories?**

A Uttarakhand

B Jammu and Kashmir

C Lakshadweep

D Assam

Answer: B

SSC CGL Previous Papers (DOWNLOAD PDF)

89. **Which of the following states was popularly known as the 'Land of Gods'? It got a separate identity as a state on 9 November 2000.**

A Telangana

B Goa

C Karnataka

Downloaded from cracku.in

D Uttarakhand

Answer: D

90. **'Pradhan Mantri Awas Yojana (Urban)-PMAY (U)'s mission is to achieve the goal of Housing for All in urban areas by:**

A 2020

B 2023

C 2022

D 2021

Answer: C

91. **Which of the following is NOT an example of an optical disk?**

A Blue Ray Disk

B PROM

C CD ROM

D DVD

Answer: B

SSC CGL Free Mock Test (Latest Pattern)

92. **A device or program that enables a computer to transmit data over telephone or cable lines is called:**

A motherboard

B modem

C monitor

D mouse

Answer: B

93. **Where was the Patrika Gate inaugurated by Prime Minister Narendra Modi in September 2020?**

A Jaipur

B Ranchi

C Raipur

D Bhopal

Answer: A

94. **Who among the following was honoured with the long-overdue record title for 'fastest human computation' by Guinness World Records on 30 July 2020?**

A Shakuntala Devi

Downloaded from cracku.in

B Vashishtha Narayan Singh

C Vijay Kumar Patodi

D Shreeram Shankar Abhyankar

Answer: A

SSC CHSL Important Questions and Answers (Download PDF)

95. **The mutual funds industry in India is regulated by which of the following organisations?**

A IRDA and IFCI

B SEBI and RBI

C NITI Aayog and IIFCL

D Ministry of Commerce and SIDBI

Answer: B

96. **Who among the following was responsible for the partition of Bengal in 1905?**

A Lord Mayo

B Lord Canning

C Lord Ripon

D Lord Curzon

Answer: D

97. **Where is the Sariska Tiger Reserve located?**

A Rajasthan

B Haryana

C Gujarat

D Karnataka

Answer: A

SSC CHSL Study Material

98. **In September 2020, who was appointed as Executive Director of Asian Development Bank, Manila?**

A Warotai Kosolpisitkul

B Jason Chung

C Sameer Khare

D Rajesh Khullar

Answer: C

Downloaded from cracku.in

99. **Which of the following gases is released in the process of photosynthesis?**

A Nitrous dioxide

B Carbon dioxide

C Oxygen

D Nitrogen

Answer: C

100. **The total liability of the monetary authority of the country, Reserve Bank of India, is called:**

A Hot money

B Grey money

C Cold cash

D High powered money

Answer: D

SSC CHSL Free App

SSC CHSL Free Mock Test

SSC CHSL Prevoius Papers (DOWNLOAD PDF)

SSC CGL Previous Papers (DOWNLOAD PDF)

SSC CGL Free Mock Test (Latest Pattern)

SSC CHSL Important Questions and Answers (Download PDF)

SSC CHSL Study Material

SSC CHSL Free App

Daily Free SSC Practice Set

Free SSC Study Material (18,000 Solved Questions)

1500+ Very Important Free SSC Solved Questions

Downloaded from cracku.in

SSC Exam Update Videos & Free Study Material (YouTube Channel)

Latest Job Updates on Telegram - Join here

Join SSC Daily Quiz Telegram Group

Downloaded from cracku.in